Name _____ Score: _____

The Cups Carving Contest

Rick, Joy, Rincy, and John were in a pumpkin carving contest. There was a prize for the person who carved the most cups.

Number of Cups Carved

Rick	
Joy	
Rincy	
John	

= 2 cups

1. How many cups did John carve? _____

2. How many cups did Joy carve? _____

3. How many cups did Rincy carve? _____

4. How many cups did Rick carve? _____

5. How many more cups did John carve than Rincy? _____

6. How many cups did Joy and Rincy carve in all? _____

7. Which person carved the greatest number of cups? _____

8. Which person carved the least number of cups? _____

9. If Joy carved 4 more cups, how many cups would he have carved in all? _____

10. If Rick had carved 3 fewer cups, how many would he has carved? _____

11. How many more cups did Rick carve than Rincy? _____

12. How many cups did the 4 contestants carve altogether? _____

©AGradeMath Worksheets www.agrademath.com

Name _____ Score: _____

The Cups Carving Contest

Rick, Joy, Rincy, and John were in a pumpkin carving contest. There was a prize for the person who carved the most cups.

Number of Cups Carved

Rick	
Joy	
Rincy	
John	

= 2 cups

1. **How many cups did John carve?** **16 cups**
2. **How many cups did Joy carve?** **10 cups**
3. **How many cups did Rincy carve?** **12 cups**
4. **How many cups did Rick carve?** **14 cups**
5. **How many more cups did John carve than Rincy?** **4 cups**
6. **How many cups did Joy and Rincy carve in all?** **22 cups**
7. **Which person carved the greatest number of cups?** **John**
8. **Which person carved the least number of cups?** **Joy**
9. **If Joy carved 4 more cups, how many cups would he have carved in all?** **18 cups**
10. **If Rick had carved 3 fewer cups, how many would he has carved?** **8 cups**
11. **How many more cups did Rick carve than Rincy?** **2 cups**
12. **How many cups did the 4 contestants carve altogether?** **52 cups**

©AGradeMath Worksheets www.agrademath.com